PRESIDENT'S OFFICE– REGIONAL ADIMINISTRATION AND LOCAL GOVERNMENT

EVALUATION TOOL FOR ARITHMETICS MASTERING STANDARD TWO.

PUPIL'S NAME_____
SCHOOL NAME_____ **COUNCIL**_____ **REGION** _____
NOVEMBER, 2024. TIME 1:30

1. *Write in numerals*

(i) *Nine hundred and ninety nine*_____

(ii) *Five hundred and fifteen* _____

Write in words

(iii) *213 =* _____.

(iv) *77 =* _____.

(v) *622 =* _____.

Write the missing numbers

(i) *410, 510, _____, 710, 810.*

(ii) *900, 800, 700, _____, 500.*

(iii) *502, _____, 506, 508, 510.*

(iv) *40 +* ☐ *= 100*

(v) ☐ *- 250 = 250*

3. *Addition*

(i) *633 + 230 =* ☐

(ii)
229
+ 229
☐

(iii)
700
+ 230
☐

(iv)
469
+ 31
☐

(v)
469
+ 30
☐

4. *Subtraction*

(i) *490 - 250 =* ☐

(ii)
863
- 289
☐

(iii)
600
- 482
☐

Write the fraction of the shaded part

(iv)  _____

Name the following shape

(v) 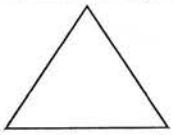 _____

5. *Which is not a plane shape?*

(i) 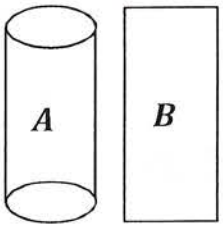

A or B?
_____

(ii) *How many 100 shillings are their in 1000 shillings?*

(iii) *Juma had 649 eggs. He sold 415 eggs. How many eggs remained with him?*

(iv) *The school bought 333 desks. Later the school bought 426 more desks. What was the total number of desk?*

(v) *Ali went to the market. He bought apples for 300 shillings. He also bought oranges for 700 shillings. How much did he spend?*