# WIZARA YA ELIMU NA MAFUNZO YA UFUNDI
## MTIHANI WA TAIFA WA DARASA LA NNE - 2014

**051** **SOMO: HISABATI**

**JINA LA MTAHINIWA: ……**
**JINA LA SHULE: ……**
**HALMASHAURI: ……....**
**MKOA: ……**

**MUDA: SAA 1:15**

**MAELEKEZO:**

1. **Mtihani huu una jumla ya maswali 25.**
2. **Jibu maswali yote kama ilvyoelekezwa katika kila swali.**
3. **Majibu ya maswali yote yaandikwe kwenye nafasi zilizotolewa katika kila swali.**
4. **Kumbuka kuandika jina lako, jina la shule, halmashauri na mkoa.**
5. **Simu za mkononi na kikokotoo haviruhusiwi kwenye chumba cha mtihani.**

**Jibu maswali yafuatayo:**

| NA. | SWALI | SEHEMU YA KAZI | JIBU |
|---|---|---|---|
| 1. | 9 + 117 + 1018 = | | |
| 2. | 1340 - 685 | | |
| 3. | 314<br>×14 | | |
| 4. | $13\overline{)8099}$ | | |
| 5. | Jumlisha: 27 + 18 = _____<br>(Andika jawabu kwa namba za kirumi). | | |
| 6. | Badili XVII kuwa namba za kawaida. | | |
| 7. | $\frac{1}{12} + \frac{5}{12} + \frac{4}{12} =$ | | |
| 8. | $\frac{11}{14} - \frac{8}{14} =$ | | |
| 9. | Andika sehemu iliyotiwa kivuli.<br> | | |
| 10. | Kuna mistari minyoofu mingapi katika mchoro ufuatao?<br> | | |
| 11. | Urefu wa mstatili ni meta 50 na upana wake ni meta 40. Tafuta eneo lake. | | |
| 12. | Tafuta eneo la mraba ambao urefu wa upande wake mmoja ni meta 30<br>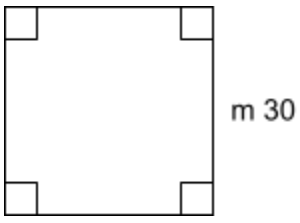 | | |

| | | | |
|---|---|---|---|
| 13. | Tafuta mzingo wa mraba huu.<br>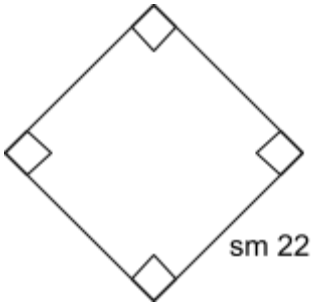<br> | | |
| 14. | m30 + m45 = | | |
| 15. | Badili mm 20 kuwa sentimeta. | | |
| 16. | Badili kilogramu 4 kuwa gramu | | |
| 17. | Mama anahitaji lita 2 za maziwa. Je atanunua paketi ngapi za maziwa za ½ lita? | | |
| 18. | Saa Dakika<br>6 45<br>+ 2 59<br>_____ | | |
| 19. | Saa Dakika<br>8 00<br>- 2 50<br>_____ | | |
| 20. | Andika muda ufuatao kwa tarakimu.<br>Saa kumi na mbili kasoro robo. | | |

| | | | |
|---|---|---|---|
| 21. | Idadi ya wakazi katika vijiji vitatu imeoneshwa kewenye grafu ya muhimili ufuatao. Tafuta jumla ya wakazi wa vijiji vyote vitatu.<br>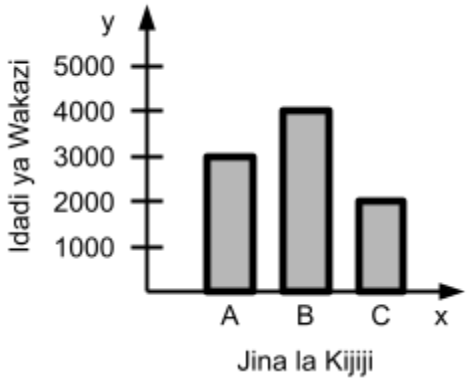<br> | | |
| 22. | Sh. St.<br>2680 30<br>+ 130 60<br>_____ | | |
| 23. | Sh. St.<br>1850 00<br>- 99 25<br>_____ | | |
| 24. | Sh. St.<br>120 30<br>x 4<br>_____ | | |
| 25. | Caroli alinunua bidhaa zifuatazo: machungwa 3 @ Sh. 100, embe 7 @ Sh. 350, mapapai 9 @ Sh. 1000 na paketi 10 za maziwa @ Sh. 650. Alilipa kiasi gani cha fedha kwa bidhaa zote? | | |