Pupil's Assessment Number:.....

THE UNITED REPUBLIC OF TANZANIA

THE NATIONAL EXAMINATIONAL COUNCIL OF TANZANIA

STANDARD FOUR NATIONAL ASSESSMENT

04E **MATHEMATICS**

Time: 1:30 Hours **Year: 2015.**

Instructions

1. This paper consists of **twenty five (25)** questions.
2. Answer **all** questions.

Pupil's Assessment Number:.....

No.	Question	Working space	Answer
1.	Write the number of sweets in the following diagram: 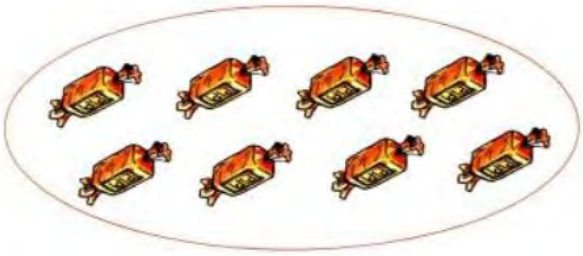		
2.	Write "five thousand seven hundred and forty nine" in figures		
3.	72 + 16 =		
4.	3566 – 2285 =		
5.	1 1 5 x 6		
6.	Divide; 8) 456		

Pupil's Assessment Number:.....

No.	Question	Working space	Answer
7.	The book has 125 pages. How many pages are there in 150 books of that kind?		
8.	Victoria shared a loaf with her three friends. If, everyone got an equal piece, what fraction of the loaf was given to each of them?		
9.	What fraction is shaded in following figure? 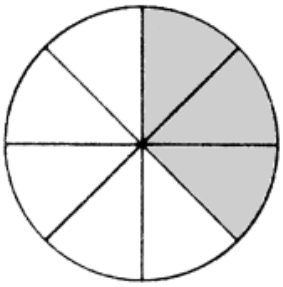		
10.	$\frac{3}{10}+\frac{5}{10}=$		
11.	$\frac{5}{9}-\frac{2}{9}=$		

Pupil's Assessment Number:.....

No.	Question	Working space	Answer
12.	How many 500 shillings notes are there in a note of 10,000 shillings?		
13.	7,425 shillings + 255 shillings =		
14.	Joyce bought the following items at the market: 7 oranges @ sh. 200.00, 8 bananas @ sh. 250.00, 9 mangoes @ sh. 500.00. How much money did she spend?		
15.	Find the perimeter of the rectangle ABCD 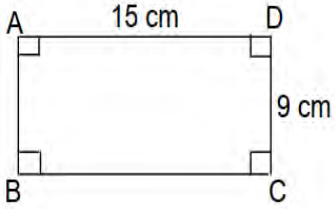		
16.	Shaame has a square shaped farm. If one side has a length of 50 m. Find the perimeter of the farm.		

Pupil's Assessment Number:.....

No.	Question	Working space	Answer
17.	Find the area of the following rectangle: 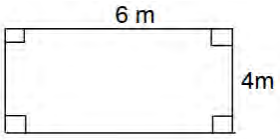 		
18.	Tabora Airport is 600 m long and 100 m wide. Find its area in hectares.		
19.	Write down the time shown on the following clock: 		
20.	Asha bought 3 kg of rice. How many grams of rice did she buy?		
21.	Add; Hours Minutes 5 25 + 2 15 _____ _____		
22.	Mwanaidi travelled by UDA bus service for 1 hour and 10 minutes and then walked for 1 hour and 15 minutes. How long did she travel?		

Pupil's Assessment Number:.....

No.	Question	Working space	Answer
23.	Write XXIV in ordinary numbers.		
24.	Change 67 to Roman numbers.		
25.	The following graph shows the number of motorcycle accidents in Mjimwema village for a period of four months: 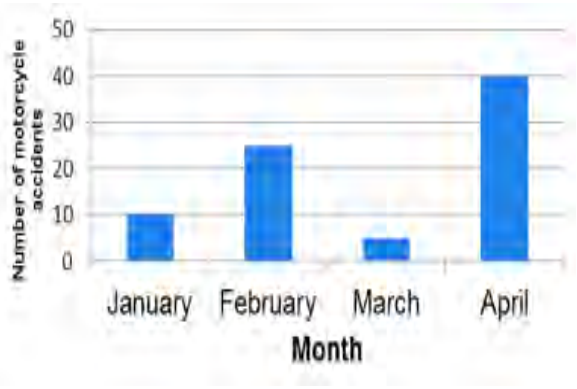 Which month was found to have a small number of motorcycle accidents?		